Name: _____

Doubles Facts

1 + 1 = green **2 + 2 = blue** **3 + 3 = brown** **4 + 4 = yellow** **5 + 5 = orange**

6 + 6 = purple **7 + 7 = pink** **8 + 8 = red** **9 + 9 = black** **10 + 10 = gray**



© LoveLEARNING

Even and Odd BUGS

Name: _____

Solve the addition and subtraction equations. Determine if the answers are even or odd and color the correct bug. Match the answer from the equation to the number at the bottom of the page. Fill in the blank with the letter from the box. A mystery sentence will be revealed.

s 8 + 7 = _____ Even Odd	**u** 17 - 5 = _____ Even Odd	
r 14 - 6 = _____ Even Odd	**e** 9 + 9 = _____ Even Odd	**g** 12 + 4 = _____ Even Odd
a 10 + 9 = _____ Even Odd	**h** 13 - 3 = _____ Even Odd	**t** 15 - 8 = _____ Even Odd
n 16 - 7 = _____ Even Odd	**b** 5 + 9 = _____ Even Odd	**i** 11 - 5 = _____ Even Odd

___ ___ ___	___ ___ ___ ___	___ ___ ___
7 10 18	14 12 16 15	19 8 18

___ ___	___ ___ ___	___ ___ ___ ___ ___ .
6 9	7 10 18	16 8 19 15 15

© A Spoonful of Learning

Name: _____

Mystery Numbers

Look at the given number. Write the numbers that are one more and one less than the given number in the boxes on the left. Write the numbers that are ten more and ten less than the given number in the boxes on the right.

1 Less	Number	1 More
	68	
	40	
	85	
	59	
	76	

10 Less	Number	10 More
	54	
	72	
	67	
	33	
	81	

Determine the number that is missing in the boxes. Use the given numbers as clues.

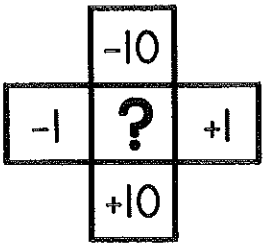



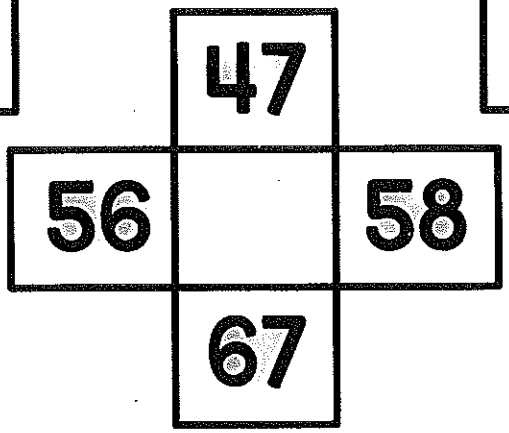

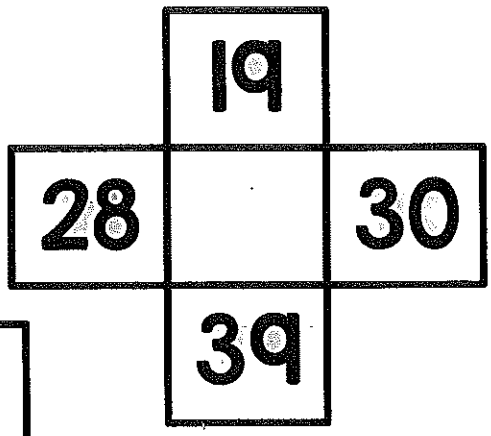

© A Spoonful of Learning

Missing Addend Word Problems

Name: _____

Read the word problem. Draw pictures in the box to help you solve the word problem. Write the missing addend of the equation on the line.

Mike caught 8 bugs. Then he caught some more bugs. Now he has 12 bugs. How many more bugs did Mike catch? 8+____=12	My friend brought 20 cupcakes to class for her birthday. 14 of them were chocolate and the rest were vanilla. How many cupcakes were vanilla? 14+____=20	There are 15 kids at the park. 7 of the kids are boys and the rest are girls. How many kids are girls? 7+____=15
There are 14 flowers in the garden. 7 of them are yellow and the rest are red. How many flowers are red? 7+____=14	Jess saw 11 worms in the ground. 6 of the worms were long and the rest were short. How many worms were short? 6+____=11	Jack ate 4 grapes. His brother ate more than him. In all, they ate 13 grapes. How many grapes did Jack's brother eat? 4+____=13

© A Spoonful of Learning

Name: _____

Count the Coins

Directions: Count the coins and write the amount in the box.

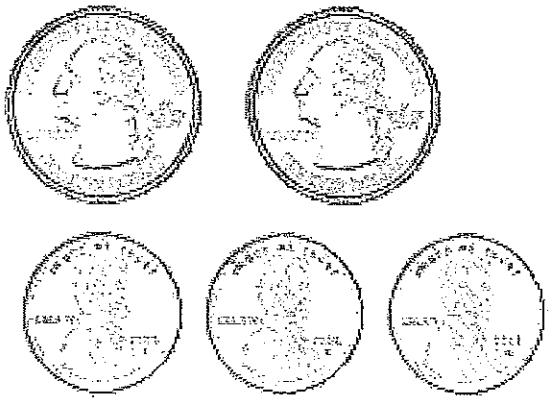

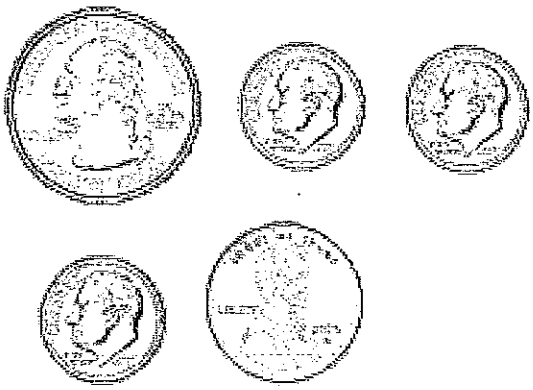



Jellyfish Add

Color any 3 numbers that can make an addition equation.

a game for 2 players **Need: Pencils**

Players take turns to color any 3 numbers on the board that can make an addition equation. The numbers can be anywhere on the board, e.g. A player could color 6, 8 and 14 for 6+8=14. The last player to color 3 numbers to make an addition equation is the winner.





Game 1

16	18	12	9	15	11
8	9	9	8	9	6
12	15	9	14	10	6
6	7	6	10	2	5
13	14	7	12	7	13
11	15	5	4	16	6
17	3	7	9	8	11
5	8	5	11	10	13
6	2	9	7	7	3
5	7	13	17	12	4
4	14	15	4	8	14
8	8	7	3	9	11

Game 2

5	7	13	9	8	11
4	14	15	11	10	13
8	8	7	7	7	3
11	17	12	4	15	11
17	4	8	14	9	6
5	3	9	11	10	6
6	15	4	19	2	5
15	9	14	12	7	13
16	18	12	9	15	5
8	9	9	8	3	7
6	7	6	10	8	5
13	14	7	12	2	9